ΟΝΟΜΑ: _____

Μαθηματικά 1η Ενότητα

4. Οι αριθμοί από το 1 έως το 5

1. Σχεδιάζω τόσες γραμμούλες όσες μου δείχνουν τα δάχτυλα.

2. Πόσα είναι τα μπαλόνια; Ενώνω τα κουτάκια με το σωστό αριθμό που δείχνουν τα ζάρια.







3. Κυκλώνω κάθε φορά όσα καραβάκια λέει ο αριθμός.

3	
1	
5	
2	
4	
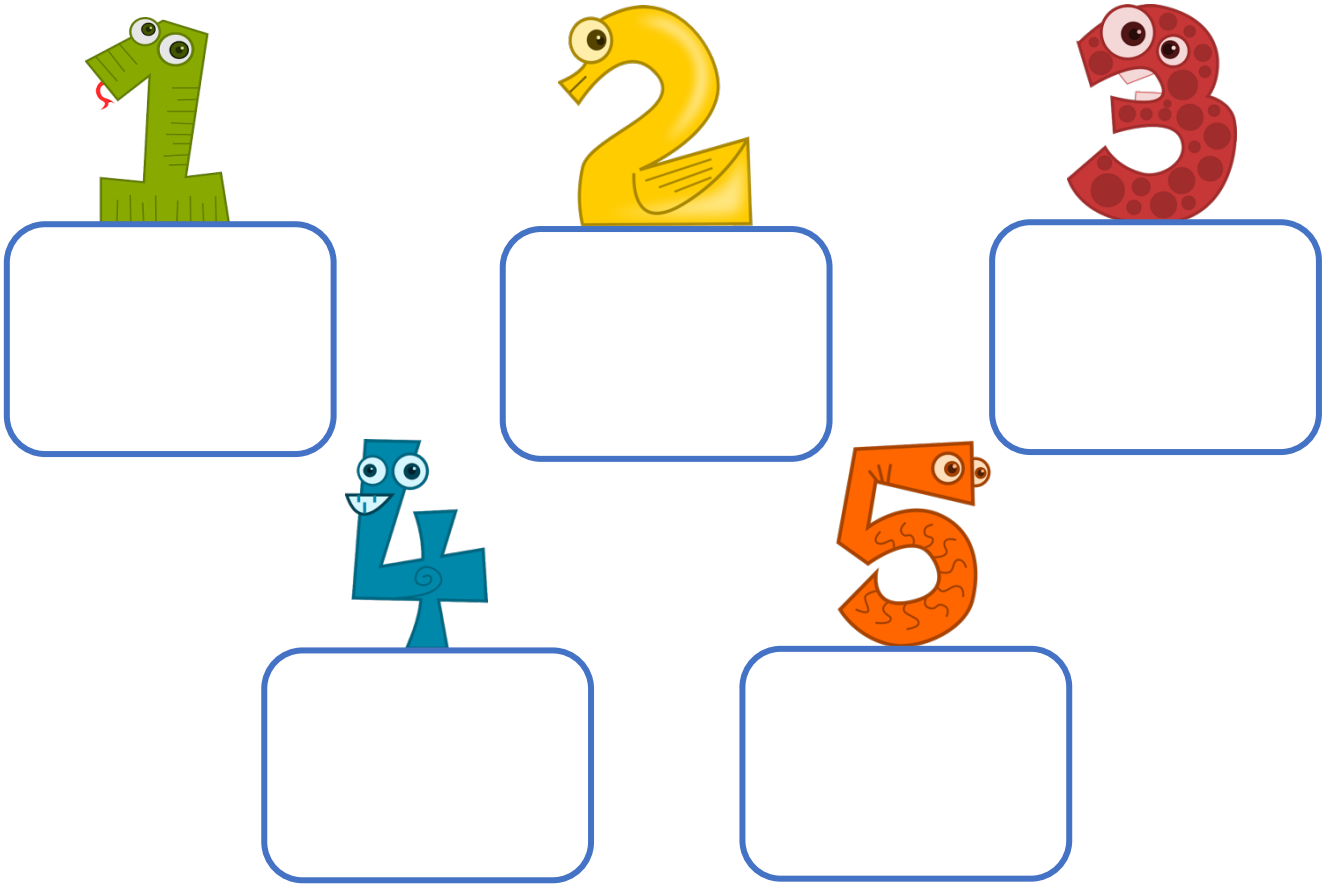
4. Ζωγραφίζω τόσα κυκλάκια όσα λέει ο αριθμός.